Colocar Números en Rectas Numéricas (I)

Nombre: _____ Fecha: _____ Puntuación: _____

Dibujen una estrella en el lugar de la recta numérica donde se encontraría cada número.

4825



9028



8390



215



6219



5807



2029

3068



7840



1266



Colocar Números en Rectas Numéricas (I) Respuestas

Nombre: _____ Fecha: _____ Puntuación: _____

Dibujen una estrella en el lugar de la recta numérica donde se encontraría cada número.

4825

9028



8390



215



6219



5807



2029



3068



7840



1266