Colocar Números en Rectas Numéricas (I)

Nombre: _____ Fecha: _____ Puntuación: _____

Dibujen una estrella en el lugar de la recta numérica donde se encontraría cada número.

4825



9028



8390



215



6219



5807



2029

3068



7840



1266