Colocar Números en Rectas Numéricas (D)

Nombre: _____ Fecha: _____ Puntuación: _____

Dibujen una estrella en el lugar de la recta numérica donde se encontraría cada número.

30



20



100

40



80



10



60



70

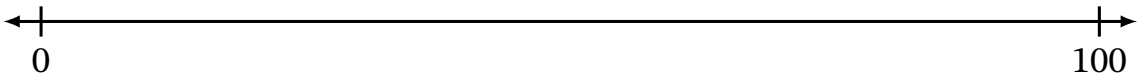

90



50



Colocar Números en Rectas Numéricas (D) Respuestas

Nombre: _____ Fecha: _____ Puntuación: _____

Dibujen una estrella en el lugar de la recta numérica donde se encontraría cada número.

30

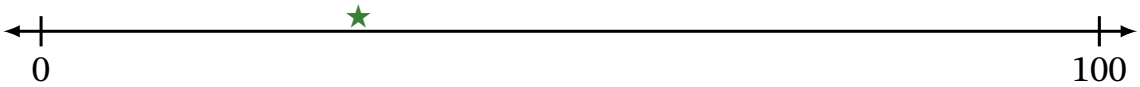

20



100



40



80

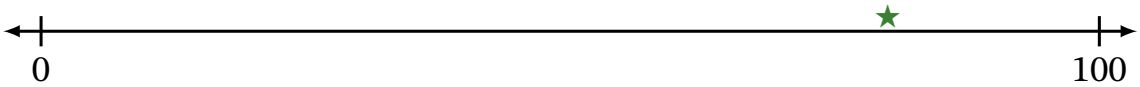

10

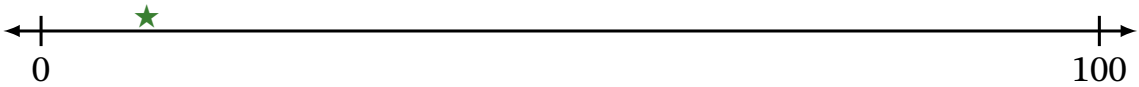

60

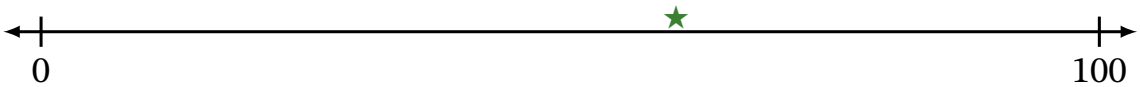

70

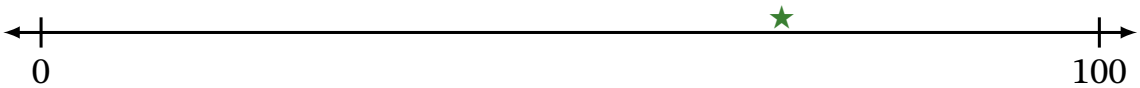

90

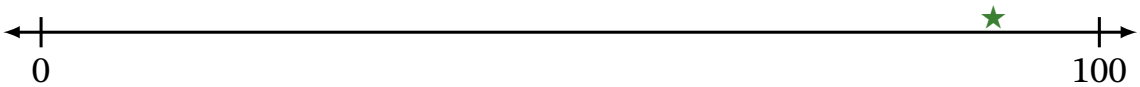

50