Colocar Números en Rectas Numéricas (G)

Nombre: _____ Fecha: _____ Puntuación: _____

Dibujen una estrella en el lugar de la recta numérica donde se encontraría cada número.

700



300



600

500



400



900



1000



800

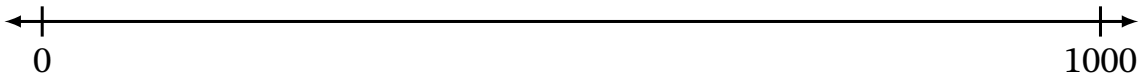

200



100



Colocar Números en Rectas Numéricas (G) Respuestas

Nombre: _____ Fecha: _____ Puntuación: _____

Dibujen una estrella en el lugar de la recta numérica donde se encontraría cada número.

700

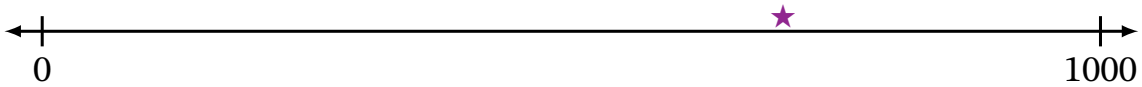

300

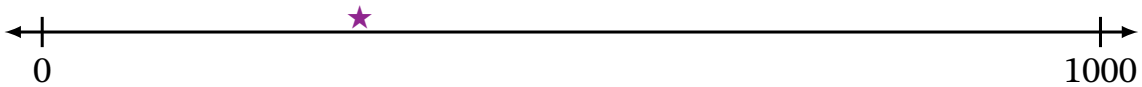

600



500

400

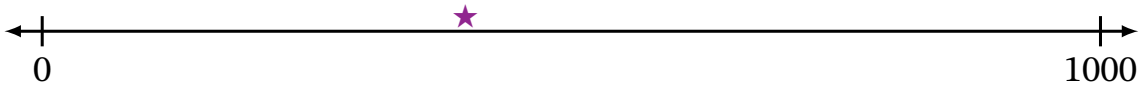

900

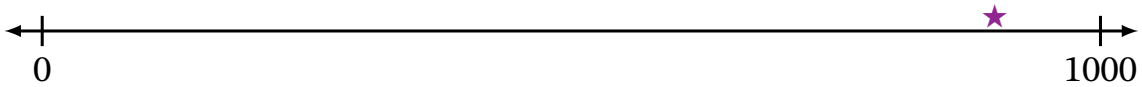

1000



800



200


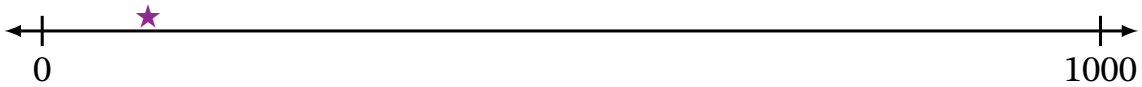
100