Colocar Números en Rectas Numéricas (C)

Nombre: _____ Fecha: _____ Puntuación: _____

Dibujen una estrella en el lugar de la recta numérica donde se encontraría cada número.

9000



2000



8000

3000



1000



5000



4000



10.000

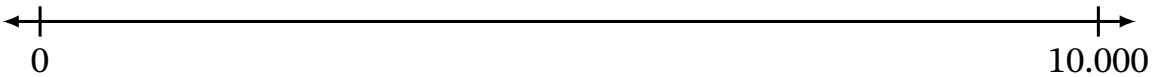

6000



7000