Colocar Números en Rectas Numéricas (G)

Nombre: _____ Fecha: _____ Puntuación: _____

Dibujen una estrella en el lugar de la recta numérica donde se encontraría cada número.

5000



4000



2000

6000



7000



0



10.000



8000

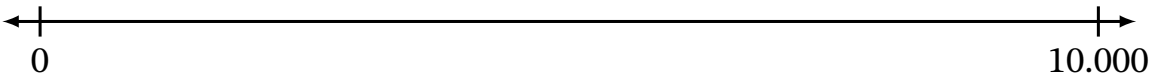

3000



9000



Colocar Números en Rectas Numéricas (G) Respuestas

Nombre: _____ Fecha: _____ Puntuación: _____

Dibujen una estrella en el lugar de la recta numérica donde se encontraría cada número.

5000

4000

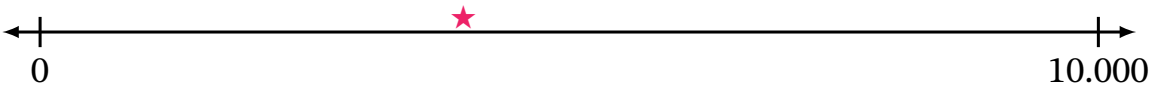

2000



6000



7000

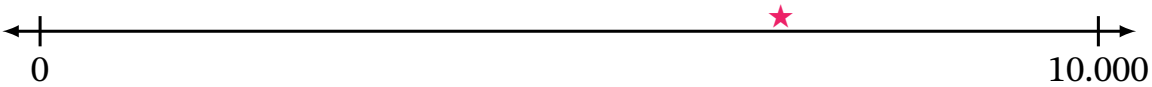

0

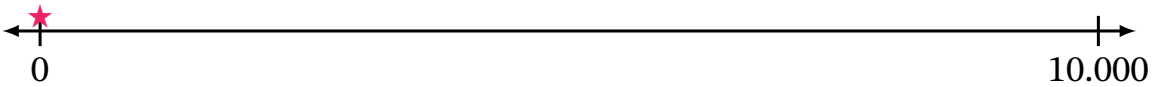

10.000



8000



3000


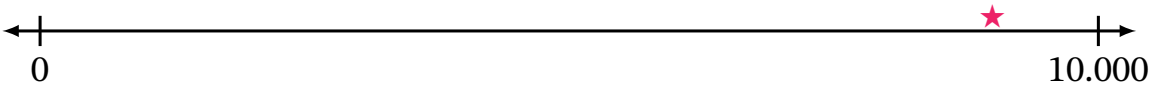
9000