Colocar Números en Rectas Numéricas (H)

Nombre: _____ Fecha: _____ Puntuación: _____

Dibujen una estrella en el lugar de la recta numérica donde se encontraría cada número.

6000



0



2000

9000



8000



5000



3000



10.000

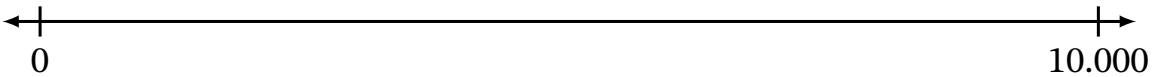

4000



7000