Colocar Números en Rectas Numéricas (I)

Nombre: _____ Fecha: _____ Puntuación: _____

Dibujen una estrella en el lugar de la recta numérica donde se encontraría cada número.

9000



7000



4000

0



5000



8000



10.000



2000

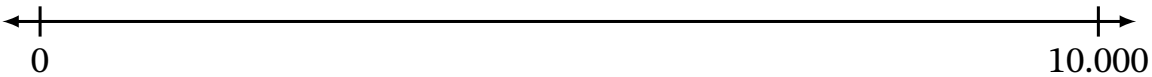

3000



6000