Colocar Números en Rectas Numéricas (G)

Nombre: _____ Fecha: _____ Puntuación: _____

Dibujen una estrella en el lugar de la recta numérica donde se encontraría cada número.

6000



8000



3000



7000



4000



10,000

2000

5000



1000



9000