Par o Impar (B)

Nombre: _____ Fecha: _____

Cuente el número de círculos y decida si es una cantidad par o impar.

Ej. 7 Par Impar

1. _____ Par Impar

2.  _____ Par Impar

3. _____ Par Impar

4. 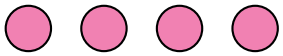 _____ Par Impar

5. _____ Par Impar

6. _____ Par Impar

7.  _____ Par Impar

8. _____ Par Impar

9. _____ Par Impar

10.  _____ Par Impar

Par o Impar (B) Respuestas

Nombre: _____ Fecha: _____

Cuente el número de círculos y decida si es una cantidad par o impar.

Ej. 7 Par **Impar**

1. 5 Par **Impar**

2.  2 **Par** Impar

3. 7 Par **Impar**

4. 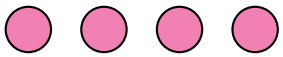 4 **Par** Impar

5. 10 **Par** Impar

6. 8 **Par** Impar

7.  6 **Par** Impar

8. 9 Par **Impar**

9. 1 Par **Impar**

10.  3 Par **Impar**