Par o Impar (J)

Nombre: _____ Fecha: _____

Cuente el número de círculos y decida si es una cantidad par o impar.

Ej. 7 Par Impar

1. _____ Par Impar

2.  _____ Par Impar

3.  _____ Par Impar

4.  _____ Par Impar

5. _____ Par Impar

6. _____ Par Impar

7. _____ Par Impar

8.  _____ Par Impar

9.  _____ Par Impar

10. _____ Par Impar

Par o Impar (J) Respuestas

Nombre: _____ Fecha: _____

Cuente el número de círculos y decida si es una cantidad par o impar.

Ej. 7 Par **Impar**

1. 1 Par **Impar**

2.  2 **Par** Impar

3.  8 **Par** Impar

4.  9 Par **Impar**

5. 5 Par **Impar**

6. 3 Par **Impar**

7. 4 **Par** Impar

8.  6 **Par** Impar

9.  10 **Par** Impar

10. 7 Par **Impar**