Diez Cuadros (B)

Nombre: _____ Fecha: _____

Represente el número en cada cuadrícula.

					3						10
					4						7
					9						8
					1						5
					2						6

Diez Cuadros (B) Respuestas

Nombre: _____ Fecha: _____

Represente el número en cada cuadrícula.

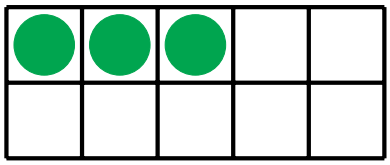

3



10

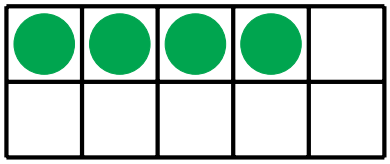

4

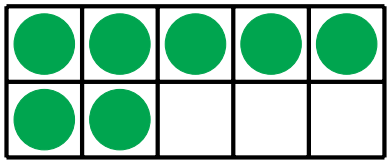

7



9



8

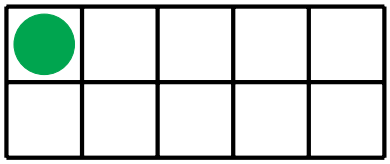

1

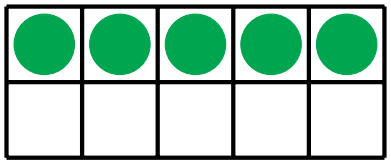

5

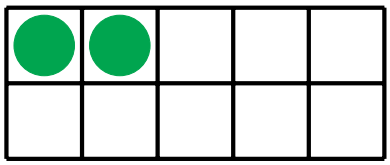

2

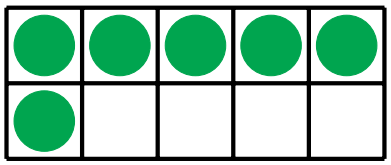

6