Diez Cuadros (C)

Nombre: _____ Fecha: _____

Represente el número en cada cuadrícula.

					7						9
					1						6
					3						4
					8						10
					2						5

Diez Cuadros (C) Respuestas

Nombre: _____ Fecha: _____

Represente el número en cada cuadrícula.

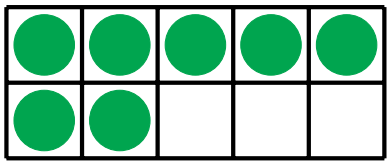

7



9

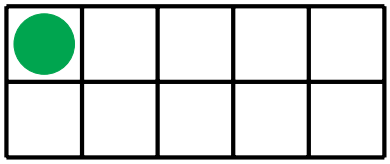

1

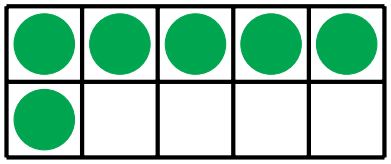

6

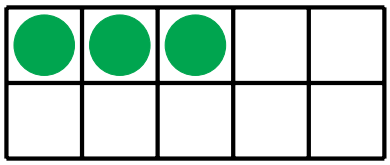

3

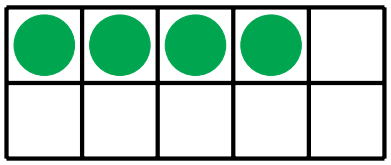

4



8



10

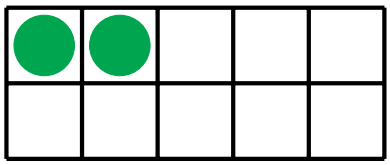

2

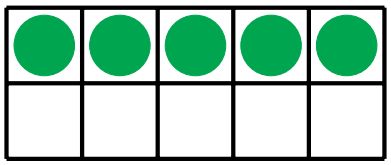

5