Dibujar la Hora en Relojes Analógicos (E)

Nombre: _____ Fecha: _____

Dibuje cada hora en el reloj que tiene encima.

1.



Medianoche Mediodía

7:02 AM

2.



Medianoche Mediodía

5:25 AM

3.



Mediodía Medianoche

10:38 PM

4.



Mediodía Medianoche

2:06 PM

Dibujar la Hora en Relojes Analógicos (E) Respuestas

Nombre: _____ Fecha: _____

Dibuje cada hora en el reloj que tiene encima.

1.



Medianoche Mediodía

7:02 AM

2.



Medianoche Mediodía

5:25 AM

3.



Mediodía Medianoche

10:38 PM

4.



Mediodía Medianoche

2:06 PM