Dibujar la Hora en Relojes Analógicos (D)

Nombre: _____ Fecha: _____

Dibuje cada hora en el reloj que tiene encima.

1.



8:05:18 PM

2.



2:08:26 PM

3.



6:02:54 AM

4.



3:03:50 AM

Dibujar la Hora en Relojes Analógicos (D) Respuestas

Nombre: _____ Fecha: _____

Dibuje cada hora en el reloj que tiene encima.

1.



8:05:18 PM

2.



2:08:26 PM

3.



6:02:54 AM

4.



3:03:50 AM