Dibujar la Hora en Relojes Analógicos (E)

Nombre: _____ Fecha: _____

Dibuje cada hora en el reloj que tiene encima.

1.



Medianoche Mediodía

6:03:30 AM

2.



Mediodía Medianoche

2:52:15 PM

3.



Mediodía Medianoche

7:16:45 PM

4.



Medianoche Mediodía

1:34:00 AM

Dibujar la Hora en Relojes Analógicos (E) Respuestas

Nombre: _____ Fecha: _____

Dibuje cada hora en el reloj que tiene encima.

1.



Medianoche Mediodía

6:03:30 AM

2.



Mediodía Medianoche

2:52:15 PM

3.



Mediodía Medianoche

7:16:45 PM

4.



Medianoche Mediodía

1:34:00 AM