Dibujar la Hora en Relojes Analógicos (J)

Nombre: _____ Fecha: _____

Dibuje cada hora en el reloj que tiene encima.

1.



Mediodía Medianoche

12:00 PM

2.



Medianoche Mediodía

4:30 AM

3.



Medianoche Mediodía

7:00 AM

4.



Mediodía Medianoche

10:30 PM

Dibujar la Hora en Relojes Analógicos (J) Respuestas

Nombre: _____ Fecha: _____

Dibuje cada hora en el reloj que tiene encima.

1.



2.



3.

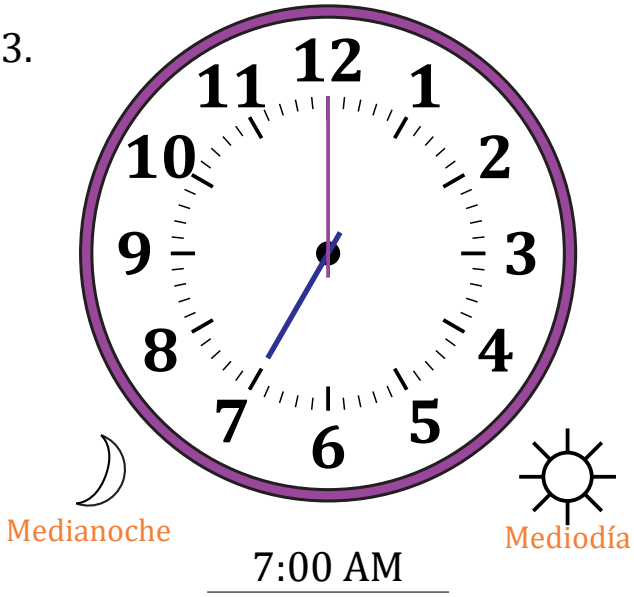

4.