Dibujar la Hora en Relojes Analógicos (E)

Nombre: _____ Fecha: _____

Dibuje cada hora en el reloj que tiene encima.

1.



10:23:30 PM

2.



3:59:00 PM

3.



6:14:30 AM

4.



5:31:00 AM

Dibujar la Hora en Relojes Analógicos (E) Respuestas

Nombre: _____ Fecha: _____

Dibuje cada hora en el reloj que tiene encima.

1.



10:23:30 PM

2.



3:59:00 PM

3.



6:14:30 AM

4.



5:31:00 AM