Dibujar la Hora en Relojes Analógicos (J)

Nombre: _____ Fecha: _____

Dibuje cada hora en el reloj que tiene encima.

1.



Medianoche Mediodía

12:00:30 AM

2.



Mediodía Medianoche

7:39:30 PM

3.



Medianoche Mediodía

9:55:00 AM

4.



Mediodía Medianoche

12:26:00 PM

Dibujar la Hora en Relojes Analógicos (J) Respuestas

Nombre: _____ Fecha: _____

Dibuje cada hora en el reloj que tiene encima.

1.



Medianoche Mediodía

12:00:30 AM

2.

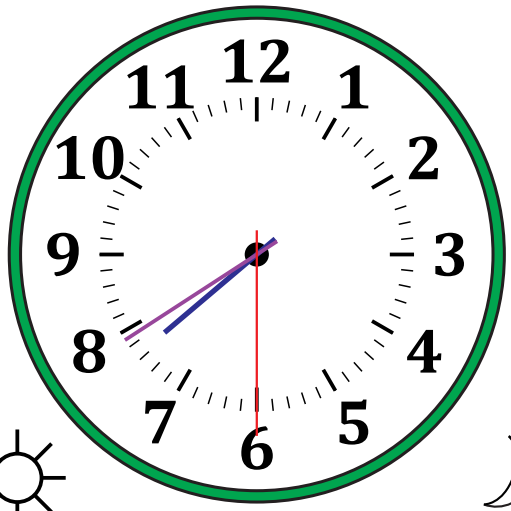

Mediodía Medianoche

7:39:30 PM

3.



Medianoche Mediodía

9:55:00 AM

4.



Mediodía Medianoche

12:26:00 PM