Dibujar la Hora en Relojes Analógicos (A)

Nombre: _____ Fecha: _____

Dibuje cada hora en el reloj que tiene encima.

1.



1:00 PM

2.



2:00 AM

3.



10:00 AM

4.



11:00 PM

Dibujar la Hora en Relojes Analógicos (A) Respuestas

Nombre: _____ Fecha: _____

Dibuje cada hora en el reloj que tiene encima.

1.



2.

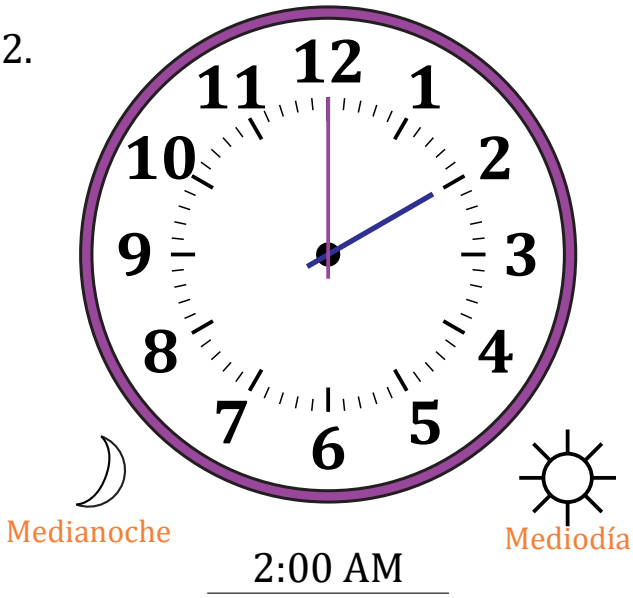

3.

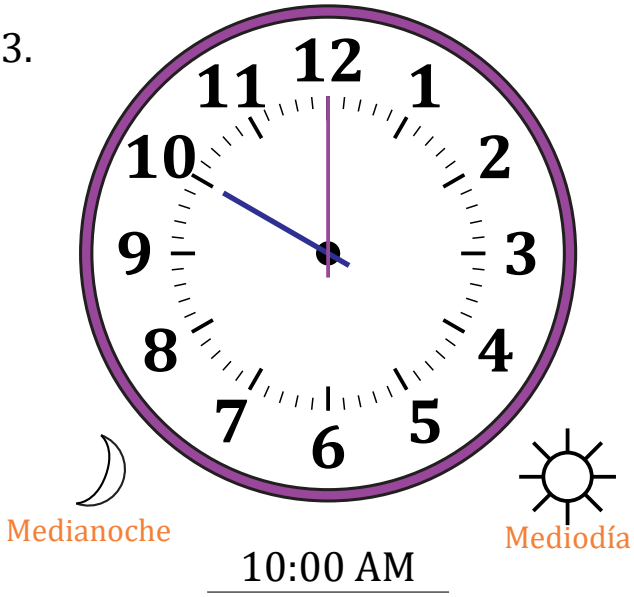

4.



Dibujar la Hora en Relojes Analógicos (B)

Nombre: _____ Fecha: _____

Dibuje cada hora en el reloj que tiene encima.

1.



Medianoche Mediodía

9:00 AM

2.



Mediodía Medianoche

12:00 PM

3.



Mediodía Medianoche

9:00 PM

4.



Medianoche Mediodía

3:00 AM

Dibujar la Hora en Relojes Analógicos (B) Respuestas

Nombre: _____ Fecha: _____

Dibuje cada hora en el reloj que tiene encima.

1.



Medianoche Mediodía

9:00 AM

2.



Mediodía Medianoche

12:00 PM

3.



Mediodía Medianoche

9:00 PM

4.



Medianoche Mediodía

3:00 AM

Dibujar la Hora en Relojes Analógicos (C)

Nombre: _____ Fecha: _____

Dibuje cada hora en el reloj que tiene encima.

1.



Medianoche Mediodía

12:00 AM

2.



Medianoche Mediodía

8:00 AM

3.



Mediodía Medianoche

9:00 PM

4.



Mediodía Medianoche

2:00 PM

Dibujar la Hora en Relojes Analógicos (C) Respuestas

Nombre: _____ Fecha: _____

Dibuje cada hora en el reloj que tiene encima.

1.



Medianoche Mediodía

12:00 AM

2.



Medianoche Mediodía

8:00 AM

3.



Mediodía Medianoche

9:00 PM

4.



Mediodía Medianoche

2:00 PM

Dibujar la Hora en Relojes Analógicos (D)

Nombre: _____ Fecha: _____

Dibuje cada hora en el reloj que tiene encima.

1.



Medianoche Mediodía

1:00 AM

2.



Mediodía Medianoche

6:00 PM

3.



Medianoche Mediodía

6:00 AM

4.



Mediodía Medianoche

4:00 PM

Dibujar la Hora en Relojes Analógicos (D) Respuestas

Nombre: _____ Fecha: _____

Dibuje cada hora en el reloj que tiene encima.

1.



Medianoche Mediodía

1:00 AM

2.



Mediodía Medianoche

6:00 PM

3.



Medianoche Mediodía

6:00 AM

4.



Mediodía Medianoche

4:00 PM

Dibujar la Hora en Relojes Analógicos (E)

Nombre: _____ Fecha: _____

Dibuje cada hora en el reloj que tiene encima.

1.



Medianoche Mediodía

12:00 AM

2.



Mediodía Medianoche

12:00 PM

3.



Mediodía Medianoche

8:00 PM

4.



Medianoche Mediodía

8:00 AM

Dibujar la Hora en Relojes Analógicos (E) Respuestas

Nombre: _____ Fecha: _____

Dibuje cada hora en el reloj que tiene encima.

1.



Medianoche Mediodía

12:00 AM

2.



Mediodía Medianoche

12:00 PM

3.



Mediodía Medianoche

8:00 PM

4.



Medianoche Mediodía

8:00 AM

Dibujar la Hora en Relojes Analógicos (F)

Nombre: _____ Fecha: _____

Dibuje cada hora en el reloj que tiene encima.

1.



Medianoche Mediodía

4:00 AM

2.



Mediodía Medianoche

10:00 PM

3.



Mediodía Medianoche

5:00 PM

4.



Medianoche Mediodía

8:00 AM

Dibujar la Hora en Relojes Analógicos (F) Respuestas

Nombre: _____ Fecha: _____

Dibuje cada hora en el reloj que tiene encima.

1.



Medianoche Mediodía

4:00 AM

2.



Mediodía Medianoche

10:00 PM

3.



Mediodía Medianoche

5:00 PM

4.



Medianoche Mediodía

8:00 AM

Dibujar la Hora en Relojes Analógicos (G)

Nombre: _____ Fecha: _____

Dibuje cada hora en el reloj que tiene encima.

1.



Mediodía Medianoche

12:00 PM

2.



Medianoche Mediodía

6:00 AM

3.



Medianoche Mediodía

5:00 AM

4.



Mediodía Medianoche

9:00 PM

Dibujar la Hora en Relojes Analógicos (G) Respuestas

Nombre: _____ Fecha: _____

Dibuje cada hora en el reloj que tiene encima.

1.



2.



3.

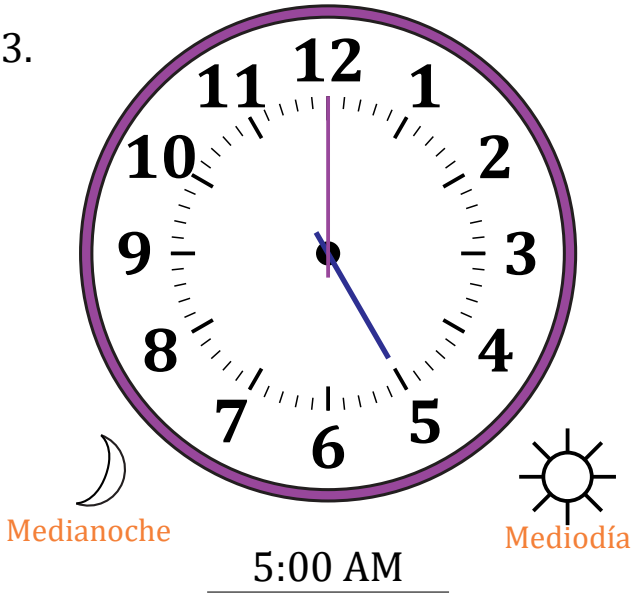

4.



Dibujar la Hora en Relojes Analógicos (H)

Nombre: _____ Fecha: _____

Dibuje cada hora en el reloj que tiene encima.

1.



6:00 PM

2.



1:00 PM

3.



7:00 AM

4.



5:00 AM

Dibujar la Hora en Relojes Analógicos (H) Respuestas

Nombre: _____ Fecha: _____

Dibuje cada hora en el reloj que tiene encima.

1.



6:00 PM

2.



1:00 PM

3.



7:00 AM

4.

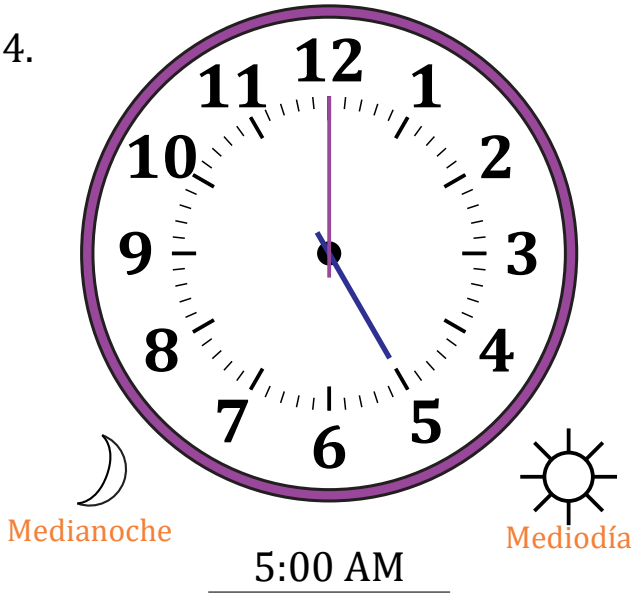

5:00 AM

Dibujar la Hora en Relojes Analógicos (I)

Nombre: _____ Fecha: _____

Dibuje cada hora en el reloj que tiene encima.

1.



6:00 PM

2.



5:00 PM

3.



7:00 AM

4.



5:00 AM

Dibujar la Hora en Relojes Analógicos (I) Respuestas

Nombre: _____ Fecha: _____

Dibuje cada hora en el reloj que tiene encima.

1.



6:00 PM

2.



5:00 PM

3.



7:00 AM

4.

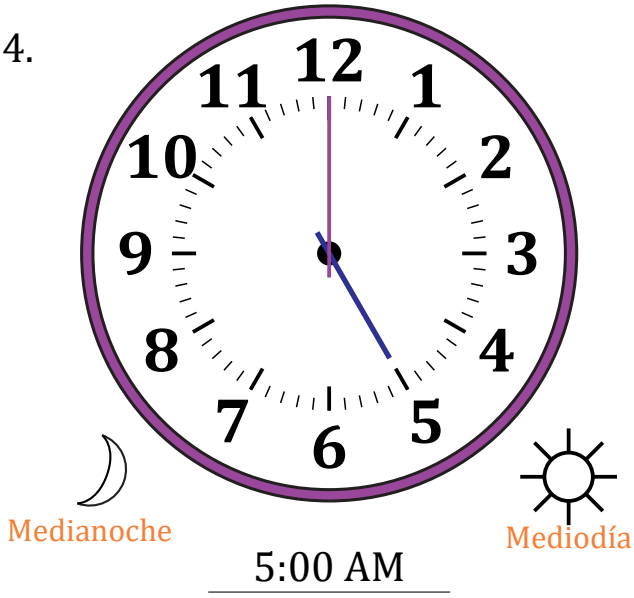

5:00 AM

Dibujar la Hora en Relojes Analógicos (J)

Nombre: _____ Fecha: _____

Dibuje cada hora en el reloj que tiene encima.

1.



Mediodía Medianoche

10:00 PM

2.



Mediodía Medianoche

12:00 PM

3.



Medianoche Mediodía

10:00 AM

4.



Medianoche Mediodía

4:00 AM

Dibujar la Hora en Relojes Analógicos (J) Respuestas

Nombre: _____ Fecha: _____

Dibuje cada hora en el reloj que tiene encima.

1.



10:00 PM

2.



12:00 PM

3.

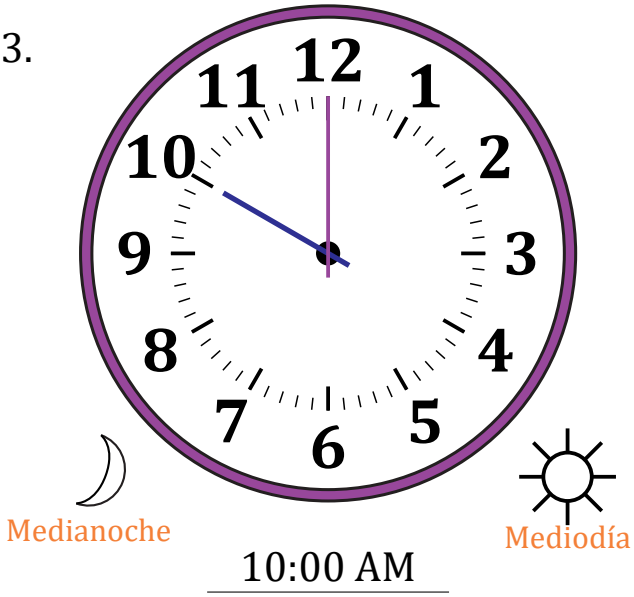

10:00 AM

4.

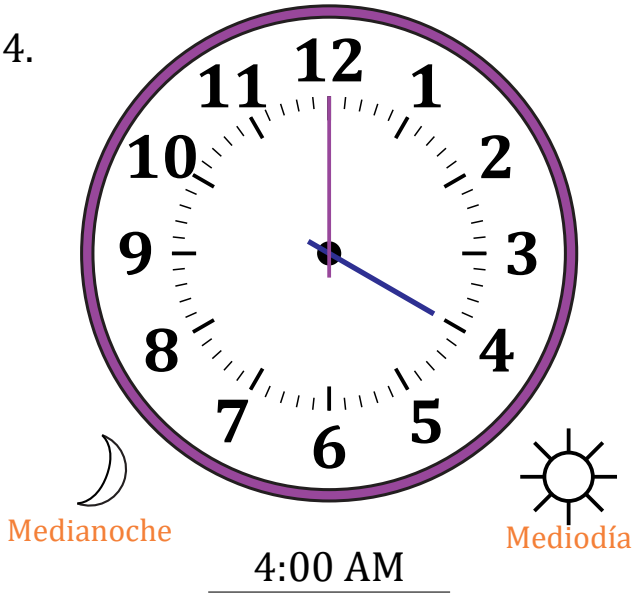

4:00 AM