# Dibujar la Hora en Relojes Analógicos (D)

Nombre: _____ Fecha: _____

Dibuje cada hora en el reloj que tiene encima.

1. 

2:27 PM

2. 

8:54 PM

3. 

1:20 PM

4. 

12:03 AM

5. 

2:14 AM

6. 

9:38 AM

7. 

11:45 AM

8. 

7:05 AM

9. 

5:45 PM

10. 

4:21 AM

11. 

11:15 PM

12. 

7:01 PM

# Dibujar la Hora en Relojes Analógicos (D) Respuestas

Nombre: _____ Fecha: _____

Dibuje cada hora en el reloj que tiene encima.

1.

2:27 PM

2.


8:54 PM

3.


1:20 PM

4.


12:03 AM

5.


2:14 AM

6.


9:38 AM

7.


11:45 AM

8.


7:05 AM

9.


5:45 PM

10.


4:21 AM

11.


11:15 PM

12.


7:01 PM