Dibujar la Hora en Relojes Analógicos (J)

Nombre: _____ Fecha: _____

Dibuje cada hora en el reloj que tiene encima.

1. 

6:26:45 PM

2. 

10:24:15 PM

3. 

5:07:00 PM

4. 

2:56:20 PM

5. 

1:10:40 AM

6. 

7:47:10 AM

7.

12:18:30 PM

8. 

5:30:55 AM

9. 

10:10:25 AM

10.

3:56:05 AM

11. 

9:25:50 AM

12. 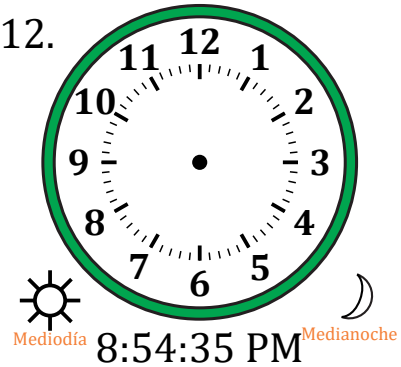

8:54:35 PM

Dibujar la Hora en Relojes Analógicos (J) Respuestas

Nombre: _____ Fecha: _____

Dibuje cada hora en el reloj que tiene encima.

1.
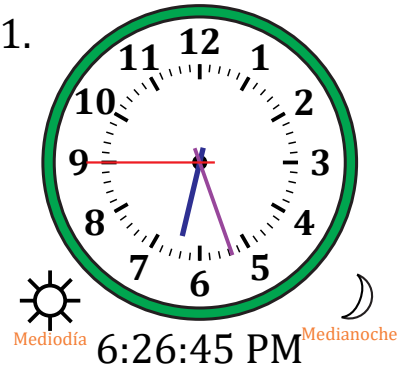

6:26:45 PM

2.
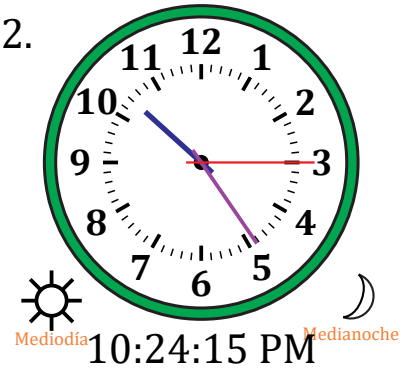

10:24:15 PM

3.


5:07:00 PM

4.

2:56:20 PM

5.

1:10:40 AM

6.

7:47:10 AM

7.

12:18:30 PM

8.

5:30:55 AM

9.


10:10:25 AM

10.

3:56:05 AM

11.

9:25:50 AM

12.
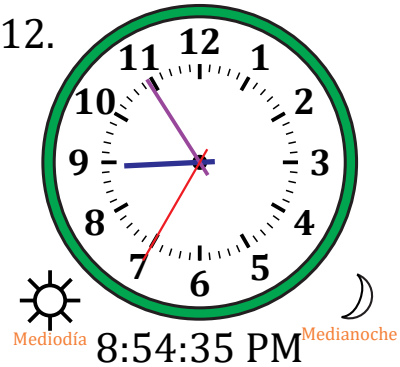

8:54:35 PM