Dibujar la Hora en Relojes Analógicos (D)

Nombre: _____ Fecha: _____

Dibuje cada hora en el reloj que tiene encima.

1. 

10:00 PM

2. 

2:30 AM

3. 

6:00 PM

4. 

2:45 PM

5. 

8:45 PM

6. 

5:15 PM

7. 

10:00 AM

8. 

8:30 AM

9. 

1:30 PM

10. 

4:45 AM

11. 

6:15 AM

12. 

12:15 AM

Dibujar la Hora en Relojes Analógicos (D) Respuestas

Nombre: _____ Fecha: _____

Dibuje cada hora en el reloj que tiene encima.

1.

10:00 PM

2.


2:30 AM

3.


6:00 PM

4.


2:45 PM

5.


8:45 PM

6.


5:15 PM

7.


10:00 AM

8.


8:30 AM

9.


1:30 PM

10.


4:45 AM

11.


6:15 AM

12.


12:15 AM