Dibujar la Hora en Relojes Analógicos (A)

Nombre: _____ Fecha: _____

Dibuje cada hora en el reloj que tiene encima.

1. 

11:15 AM

2. 

12:00 PM

3. 

6:00 AM

4. 

10:45 PM

5. 

12:30 AM

6. 

7:45 PM

7. 

3:15 AM

8. 

4:45 PM

9. 

8:30 PM

10. 

4:30 AM

11. 

2:00 PM

12. 

8:15 AM

Dibujar la Hora en Relojes Analógicos (A) Respuestas

Nombre: _____ Fecha: _____

Dibuje cada hora en el reloj que tiene encima.

1. 

11:15 AM

2. 

12:00 PM

3. 

6:00 AM

4. 

10:45 PM

5. 

12:30 AM

6. 

7:45 PM

7. 

3:15 AM

8. 

4:45 PM

9. 

8:30 PM

10. 

4:30 AM

11. 

2:00 PM

12. 

8:15 AM

Dibujar la Hora en Relojes Analógicos (B)

Nombre: _____ Fecha: _____

Dibuje cada hora en el reloj que tiene encima.

1. 

8:15 PM

2. 

1:00 PM

3. 

1:45 AM

4. 

11:00 AM

5. 

3:30 PM

6. 

7:45 AM

7. 

8:30 AM

8. 

2:00 AM

9. 

4:15 PM

10. 

10:30 PM

11. 

6:45 PM

12. 

4:15 AM

Dibujar la Hora en Relojes Analógicos (B) Respuestas

Nombre: _____ Fecha: _____

Dibuje cada hora en el reloj que tiene encima.

1.


8:15 PM

2.


1:00 PM

3.


1:45 AM

4.


11:00 AM

5.


3:30 PM

6.


7:45 AM

7.


8:30 AM

8.


2:00 AM

9.


4:15 PM

10.


10:30 PM

11.


6:45 PM

12.


4:15 AM

Dibujar la Hora en Relojes Analógicos (C)

Nombre: _____ Fecha: _____

Dibuje cada hora en el reloj que tiene encima.

1. 

8:00 AM

2. 

7:15 PM

3. 

1:45 PM

4. 

4:00 AM

5. 

11:00 AM

6. 

8:45 PM

7. 

7:30 AM

8. 

5:15 PM

9. 

3:45 AM

10. 

2:15 PM

11. 

10:30 PM

12. 

12:30 AM

Dibujar la Hora en Relojes Analógicos (C) Respuestas

Nombre: _____ Fecha: _____

Dibuje cada hora en el reloj que tiene encima.

1.


8:00 AM

2.


7:15 PM

3.


1:45 PM

4.


4:00 AM

5.


11:00 AM

6.


8:45 PM

7.


7:30 AM

8.


5:15 PM

9.


3:45 AM

10.


2:15 PM

11.


10:30 PM

12.


12:30 AM

Dibujar la Hora en Relojes Analógicos (D)

Nombre: _____ Fecha: _____

Dibuje cada hora en el reloj que tiene encima.

1. 

10:00 PM

2. 

2:30 AM

3. 

6:00 PM

4. 

2:45 PM

5. 

8:45 PM

6. 

5:15 PM

7. 

10:00 AM

8. 

8:30 AM

9. 

1:30 PM

10. 

4:45 AM

11. 

6:15 AM

12. 

12:15 AM

Dibujar la Hora en Relojes Analógicos (D) Respuestas

Nombre: _____ Fecha: _____

Dibuje cada hora en el reloj que tiene encima.

1.

10:00 PM

2.


2:30 AM

3.


6:00 PM

4.


2:45 PM

5.


8:45 PM

6.


5:15 PM

7.


10:00 AM

8.


8:30 AM

9.


1:30 PM

10.


4:45 AM

11.


6:15 AM

12.


12:15 AM

Dibujar la Hora en Relojes Analógicos (E)

Nombre: _____ Fecha: _____

Dibuje cada hora en el reloj que tiene encima.

1. 

7:30 PM

2. 

7:15 AM

3. 

2:30 AM

4. 

11:00 AM

5. 

3:45 PM

6. 

9:45 PM

7. 

10:15 PM

8. 

4:45 PM

9. 

1:15 PM

10. 

4:00 AM

11. 

12:00 AM

12. 

9:30 AM

Dibujar la Hora en Relojes Analógicos (E) Respuestas

Nombre: _____ Fecha: _____

Dibuje cada hora en el reloj que tiene encima.

1.


7:30 PM

2.


7:15 AM

3.


2:30 AM

4.


11:00 AM

5.


3:45 PM

6.


9:45 PM

7.


10:15 PM

8.


4:45 PM

9.


1:15 PM

10.


4:00 AM

11.


12:00 AM

12.


9:30 AM

Dibujar la Hora en Relojes Analógicos (F)

Nombre: _____ Fecha: _____

Dibuje cada hora en el reloj que tiene encima.

1. 

6:45 AM

2. 

3:45 AM

3. 

5:15 AM

4. 

11:00 PM

5. 

1:00 PM

6. 

7:15 PM

7. 

10:15 AM

8. 

5:30 PM

9. 

2:45 PM

10. 

9:00 PM

11. 

1:30 AM

12. 

8:30 AM

Dibujar la Hora en Relojes Analógicos (F) Respuestas

Nombre: _____ Fecha: _____

Dibuje cada hora en el reloj que tiene encima.

1.


6:45 AM

2.


3:45 AM

3.


5:15 AM

4.


11:00 PM

5.


1:00 PM

6.


7:15 PM

7.


10:15 AM

8.


5:30 PM

9.


2:45 PM

10.


9:00 PM

11.


1:30 AM

12.


8:30 AM

Dibujar la Hora en Relojes Analógicos (G)

Nombre: _____ Fecha: _____

Dibuje cada hora en el reloj que tiene encima.

1. 

8:30 AM

2. 

5:30 PM

3. 

6:45 AM

4. 

12:45 AM

5. 

6:15 PM

6. 

11:00 PM

7. 

2:00 PM

8. 

5:15 AM

9. 

9:15 PM

10. 

1:30 PM

11. 

10:45 AM

12. 

2:00 AM

Dibujar la Hora en Relojes Analógicos (G) Respuestas

Nombre: _____ Fecha: _____

Dibuje cada hora en el reloj que tiene encima.

1.


8:30 AM

2.


5:30 PM

3.


6:45 AM

4.


12:45 AM

5.


6:15 PM

6.


11:00 PM

7.


2:00 PM

8.


5:15 AM

9.


9:15 PM

10.


1:30 PM

11.


10:45 AM

12.


2:00 AM

Dibujar la Hora en Relojes Analógicos (H)

Nombre: _____ Fecha: _____

Dibuje cada hora en el reloj que tiene encima.

1. 

5:00 AM

2. 

1:15 PM

3. 

3:00 PM

4. 

7:15 PM

5. 

9:30 PM

6. 

7:45 AM

7. 

10:00 PM

8. 

2:30 AM

9. 

8:45 AM

10. 

1:30 AM

11. 

11:45 AM

12. 

4:15 PM

Dibujar la Hora en Relojes Analógicos (H) Respuestas

Nombre: _____ Fecha: _____

Dibuje cada hora en el reloj que tiene encima.

1.


5:00 AM

2.


1:15 PM

3.


3:00 PM

4.


7:15 PM

5.


9:30 PM

6.


7:45 AM

7.


10:00 PM

8.


2:30 AM

9.


8:45 AM

10.


1:30 AM

11.


11:45 AM

12.


4:15 PM

Dibujar la Hora en Relojes Analógicos (I)

Nombre: _____ Fecha: _____

Dibuje cada hora en el reloj que tiene encima.

1. 

7:00 PM

2. 

3:15 PM

3. 

5:15 AM

4. 

9:30 AM

5. 

7:30 AM

6. 

8:30 PM

7. 

10:45 PM

8. 

3:15 AM

9. 

1:45 AM

10. 

4:00 PM

11. 

12:45 PM

12. 

10:00 AM

Dibujar la Hora en Relojes Analógicos (I) Respuestas

Nombre: _____ Fecha: _____

Dibuje cada hora en el reloj que tiene encima.

1.


7:00 PM

2.

3:15 PM

3.


5:15 AM

4.


9:30 AM

5.


7:30 AM

6.


8:30 PM

7.


10:45 PM

8.


3:15 AM

9.


1:45 AM

10.


4:00 PM

11.


12:45 PM

12.


10:00 AM

Dibujar la Hora en Relojes Analógicos (J)

Nombre: _____ Fecha: _____

Dibuje cada hora en el reloj que tiene encima.

1. 

1:00 PM

2. 

4:15 AM

3. 

10:45 AM

4. 

8:00 PM

5. 

2:15 AM

6. 

3:30 PM

7. 

11:30 PM

8. 

7:45 AM

9. 

9:45 AM

10. 

1:00 AM

11. 

4:30 PM

12. 

7:15 PM

Dibujar la Hora en Relojes Analógicos (J) Respuestas

Nombre: _____ Fecha: _____

Dibuje cada hora en el reloj que tiene encima.

1.


1:00 PM

2.


4:15 AM

3.


10:45 AM

4.


8:00 PM

5.


2:15 AM

6.


3:30 PM

7.


11:30 PM

8.


7:45 AM

9.


9:45 AM

10.


1:00 AM

11.


4:30 PM

12.


7:15 PM