Dibujar la Hora en Relojes Analógicos (H)

Nombre: _____ Fecha: _____

Dibuje cada hora en el reloj que tiene encima.

1. 

3:00 AM

2. 

7:00 PM

3. 

12:00 PM

4. 

3:00 PM

5. 

12:00 AM

6. 

5:00 AM

7. 

5:00 PM

8. 

8:00 PM

9. 

11:00 PM

10. 

10:00 AM

11. 

6:00 AM

12. 

9:00 AM

Dibujar la Hora en Relojes Analógicos (H) Respuestas

Nombre: _____ Fecha: _____

Dibuje cada hora en el reloj que tiene encima.

1.


3:00 AM

2.


7:00 PM

3.


12:00 PM

4.


3:00 PM

5.


12:00 AM

6.


5:00 AM

7.


5:00 PM

8.


8:00 PM

9.


11:00 PM

10.


10:00 AM

11.


6:00 AM

12.


9:00 AM