Leer la Hora en Relojes Analógicos (D)

Nombre: _____ Fecha: _____

Lea cada hora y escríbala en el espacio debajo del reloj.

1.

_____

2.
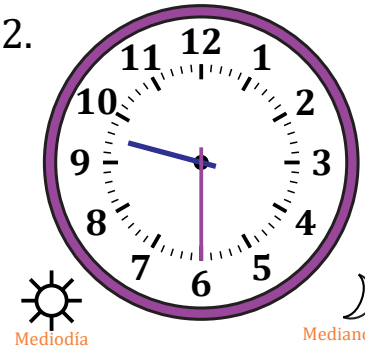

_____

3.
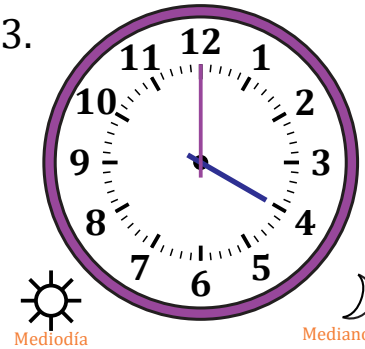

_____

4.
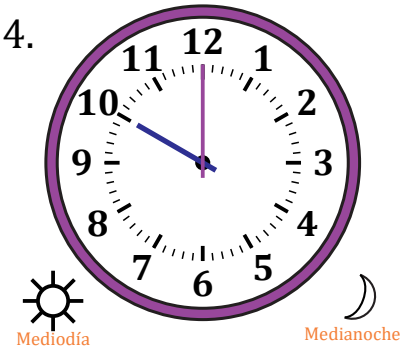

_____

5.
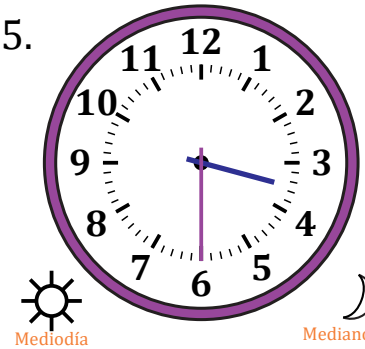

_____

6.
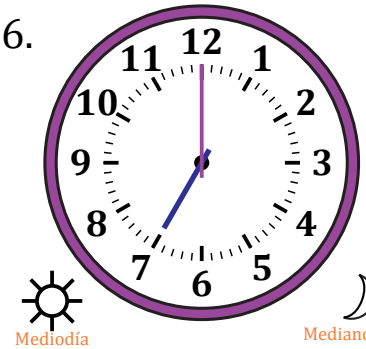

_____

7.


_____

8.
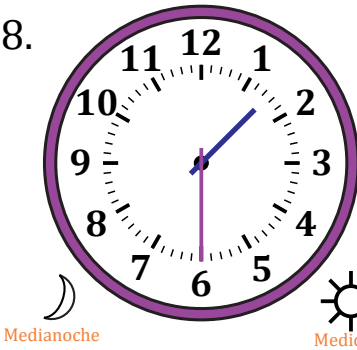

_____

9.
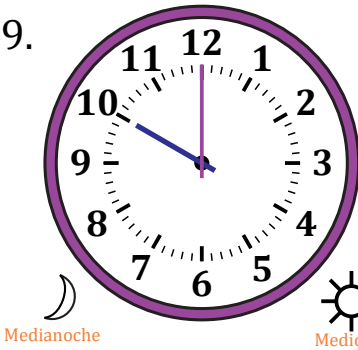

_____

10.


_____

11.
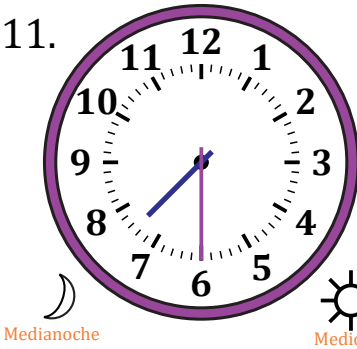

_____

12.
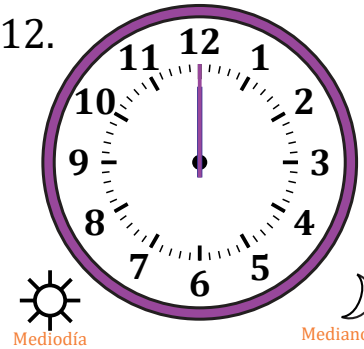

_____

Leer la Hora en Relojes Analógicos (D) Respuestas

Nombre: _____ Fecha: _____

Lea cada hora y escríbala en el espacio debajo del reloj.

1. 

9:30 AM

2. 

9:30 PM

3. 

4:00 PM

4. 

10:00 PM

5. 

3:30 PM

6. 

7:00 PM

7. 

2:30 AM

8. 

1:30 AM

9. 

10:00 AM

10. 

5:00 AM

11. 

7:30 AM

12. 

12:00 PM